Name _____

Count on Tens and Ones to Add

R 13-2 RETEACH

Find the sum.

45 + 20 = 65

Count on by tens to add.



45 55 65

21 + 3 = 24

Count on by ones to add.

21 22 23 24

Draw more tens or ones. Count on to add.

1. 18 + 30 = 48

2. 26 + 20 = _____

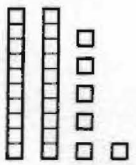

3. 32 + 4 = _____

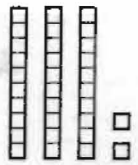

4. 41 + 10 = _____



5. 37 + 3 = _____



© Macmillan/McGraw-Hill. All rights reserved.